Question # 1

Consider a circle with centre at origin and radius r.

$$x^2 + y^2 = r^2.$$

Differentiating w.r.t. x

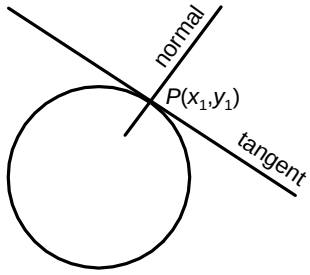

$$2x + 2y\frac{dy}{dx} = 0 \quad \Rightarrow \quad 2y\frac{dy}{dx} = -2x \quad \Rightarrow \quad \frac{dy}{dx} = -\frac{x}{y}.$$

Slope of tangent at $(x_1, y_1) = m = \left.\frac{dy}{dx}\right|_{(x_1,y_1)} = -\frac{x_1}{y_1}.$

Since normal is $\perp$ar to tangent therefore

Slope of normal at $(x_1, y_1) = -\frac{1}{m} = -\frac{1}{-x_1/y_1} = \frac{y_1}{x_1}.$

Now equation of normal at (x_1, y_1) having slope $\frac{y_1}{x_1}$

$$y - y_1 = \frac{y_1}{x_1}(x - x_1)$$

$$\Rightarrow \quad x_1 y - x_1 y_1 = y_1 x - y_1 x_1$$

$$\Rightarrow \quad x_1 y = y_1 x \quad \ldots\ldots\ldots\ldots\ldots\ldots (i)$$

Clearly centre of circle $(0,0)$ satisfies (i), hence normal lines of the circles passing through the centre of the circle.

Question # 2

Consider a circle with centre at origin and radius r.

$$x^2 + y^2 = r^2.$$

Differentiating w.r.t. x

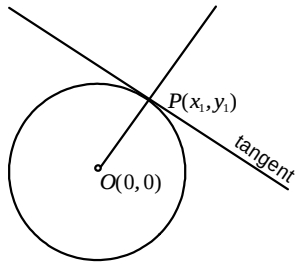

$$2x + 2y\frac{dy}{dx} = 0 \quad \Rightarrow \quad 2y\frac{dy}{dx} = -2x \Rightarrow \quad \frac{dy}{dx} = -\frac{x}{y}.$$

Slope of tangent at $(x_1, y_1) = m = \left.\frac{dy}{dx}\right|_{(x_1,y_1)} = -\frac{x_1}{y_1}.$

Slope of line $\perp$ar to tangent $= -\frac{1}{m} = -\frac{1}{-x_1/y_1} = \frac{y_1}{x_1}.$

Now equation of line perpendicular to tangent passing through centre $(0,0)$

$$y - 0 = \frac{y_1}{x_1}(x - 0)$$

$$\Rightarrow \quad x_1 y = y_1 x \quad \ldots\ldots\ldots\ldots\ldots\ldots (i)$$

Clearly the point of tangency (x_1, y_1) satisfy (i), hence the straight line drawn from the centre of circle perpendicular to a tangent passes through the point of tangency.

Question # 3

Let OAB be a right triangle with $|OA| = a$, $|OB| = b$.
Then the coordinates of A and B are $(a,0)$ and $(0,b)$ respectively.
Let C be the mid-point of hypotenuse AB. Then

$$\text{coordinate of } C = \left(\frac{a+0}{2}, \frac{0+b}{2}\right) = \left(\frac{a}{2}, \frac{b}{2}\right).$$

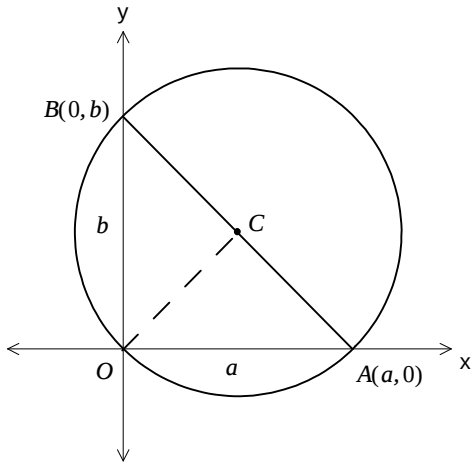

Now
$$|CA| = \sqrt{\left(\frac{a}{2}-a\right)^2 + \left(\frac{b}{2}-0\right)^2}$$
$$= \sqrt{\left(-\frac{a}{2}\right)^2 + \left(\frac{b}{2}\right)^2} = \sqrt{\frac{a^2}{4}+\frac{b^2}{4}}.$$
$$|CB| = \sqrt{\left(\frac{a}{2}-0\right)^2 + \left(\frac{b}{2}-b\right)^2}$$
$$= \sqrt{\left(\frac{a}{2}\right)^2 + \left(-\frac{b}{2}\right)^2} = \sqrt{\frac{a^2}{4}+\frac{b^2}{4}}.$$
$$|CO| = \sqrt{\left(0-\frac{a}{2}\right)^2 + \left(0-\frac{b}{2}\right)^2} = \sqrt{\frac{a^2}{4}+\frac{b^2}{4}}.$$

Since $|CA| = |CB| = |CO|$, therefore C is the centre of the circumcircle.
Hence the mid-point of the hypotenuse of a right triangle is the circumcentre of the triangle.

Mean proportional

Let a,b and c be three numbers. The number b is said to be *mean proportional* between a and b if a,b,c are in geometric means or

$$b^2 = ac \quad \text{or} \quad \frac{b}{a} = \frac{a}{c}.$$

Question # 4

Consider a circle of radius r and centre $(0,0)$, then equation of circle

$$x^2 + y^2 = r^2$$

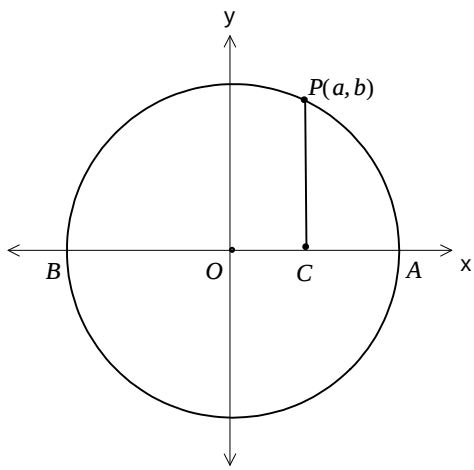

Let A and B are end-points of diameter of circle along x-axis, then coordinate of A and B are $(-r,0)$ and $(0,r)$ respectively.

Also let $P(a,b)$ be any point on circle and $\perp$ar from P cuts diameter at C. Then coordinate of C are $(a,0)$.

Since $P(a,b)$ lies on a circle, therefore

$$a^2 + b^2 = r^2 \quad \ldots\ldots\ldots\ldots (i)$$

Now

$$|AC| = \sqrt{(r+a)^2-(0-0)^2} = r+a.$$

$$|CB| = \sqrt{(r-a)^2-(0-0)^2} = r-a.$$

$$|PC| = \sqrt{(a-a)^2+(b-0)^2} = \sqrt{0+b^2} = b.$$

Now

$$\begin{aligned} |AC|\cdot|CB| &= (r+a)(r-a) \\ &= r^2-a^2 \\ &= a^2+b^2-a^2 \qquad \text{from } (i) \\ &= b^2 = |PC|^2 \end{aligned}$$

$$\Rightarrow |AC|\cdot|CB| = |PC|\cdot|PC| \qquad \Rightarrow \frac{|AC|}{|PC|} = \frac{|PC|}{|CB|}$$

$\Rightarrow |PC|$ is a mean proportional to $|AC|$ and $|CB|$.

Book: *Exercise 6.3 (Page 272)*
Calculus and Analytic Geometry Mathematic 12
Punjab Textbook Board, Lahore.
Edition: May 2005.

Available online at http://www.mathcity.org *in PDF Format.*
Page Setup used A4.
Last Update: 17 April 2011.

Error Analyst
Waiting for someone.

For news and updates visit
http://www.mathcity.org
If you have a question, ask it here
http://forum.mathcity.org

In case of error(s), please report at
http://www.mathcity.org/error